X100/302

NATIONAL QUALIFICATIONS 2010

FRIDAY, 21 MAY
10.50 AM – 12.00 NOON

MATHEMATICS
HIGHER
Paper 2

Read Carefully

1 **Calculators may be used in this paper.**

2 Full credit will be given only where the solution contains appropriate working.

3 Answers obtained by readings from scale drawings will not receive any credit.

©

FORMULAE LIST

Circle:

The equation $x^2 + y^2 + 2gx + 2fy + c = 0$ represents a circle centre $(-g, -f)$ and radius $\sqrt{g^2 + f^2 - c}$.

The equation $(x - a)^2 + (y - b)^2 = r^2$ represents a circle centre (a, b) and radius r.

Scalar Product: $\mathbf{a}.\mathbf{b} = |\mathbf{a}|\,|\mathbf{b}| \cos\theta$, where θ is the angle between **a** and **b**

or $\mathbf{a}.\mathbf{b} = a_1b_1 + a_2b_2 + a_3b_3$ where $\mathbf{a} = \begin{pmatrix} a_1 \\ a_2 \\ a_3 \end{pmatrix}$ and $\mathbf{b} = \begin{pmatrix} b_1 \\ b_2 \\ b_3 \end{pmatrix}$.

Trigonometric formulae:

$$\begin{aligned} \sin(A \pm B) &= \sin A \cos B \pm \cos A \sin B \\ \cos(A \pm B) &= \cos A \cos B \mp \sin A \sin B \\ \sin 2A &= 2\sin A \cos A \\ \cos 2A &= \cos^2 A - \sin^2 A \\ &= 2\cos^2 A - 1 \\ &= 1 - 2\sin^2 A \end{aligned}$$

Table of standard derivatives:

$f(x)$	$f'(x)$
$\sin ax$	$a\cos ax$
$\cos ax$	$-a\sin ax$

Table of standard integrals:

$f(x)$	$\int f(x)\,dx$
$\sin ax$	$-\frac{1}{a}\cos ax + C$
$\cos ax$	$\frac{1}{a}\sin ax + C$

Marks

ALL questions should be attempted.

1. The diagram shows a cuboid OPQR,STUV relative to the coordinate axes.

P is the point (4, 0, 0),
Q is (4, 2, 0) and U is (4, 2, 3).

M is the midpoint of OR.

N is the point on UQ such that $UN = \frac{1}{3}UQ$.

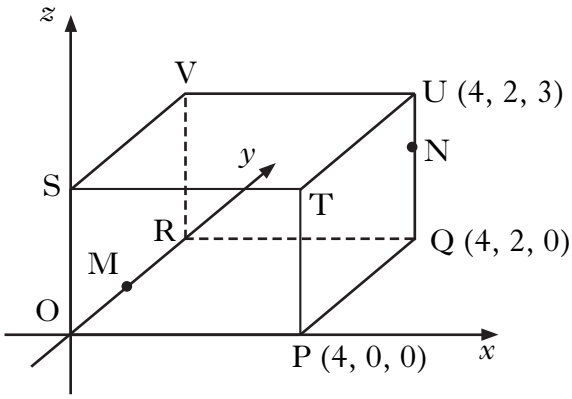

(*a*) State the coordinates of M and N. **2**

(*b*) Express $\overrightarrow{VM}$ and $\overrightarrow{VN}$ in component form. **2**

(*c*) Calculate the size of angle MVN. **5**

2. (*a*) $12\cos x° - 5\sin x°$ can be expressed in the form $k\cos(x + a)°$, where $k > 0$ and $0 \leq a < 360$.

Calculate the values of k and a. **4**

(*b*) (i) Hence state the maximum and minimum values of $12\cos x° - 5\sin x°$.

(ii) Determine the values of x, in the interval $0 \leq x < 360$, at which these maximum and minimum values occur. **3**

[Turn over

Marks

3. (*a*) (i) Show that the line with equation $y = 3 - x$ is a tangent to the circle with equation $x^2 + y^2 + 14x + 4y - 19 = 0$.

(ii) Find the coordinates of the point of contact, P. **5**

(*b*) Relative to a suitable set of coordinate axes, the diagram below shows the circle from (*a*) and a second smaller circle with centre C.

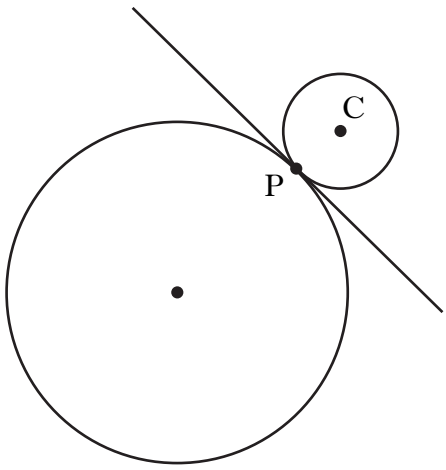

The line $y = 3 - x$ is a common tangent at the point P.

The radius of the larger circle is three times the radius of the smaller circle.

Find the equation of the smaller circle. **6**

4. Solve $2\cos 2x - 5\cos x - 4 = 0$ for $0 \leq x < 2\pi$. **5**

5. The parabolas with equations $y = 10 - x^2$ and $y = \frac{2}{5}(10 - x^2)$ are shown in the diagram below.

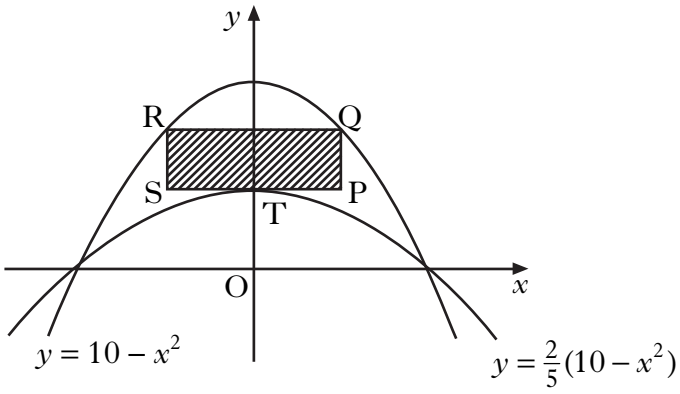

A rectangle PQRS is placed between the two parabolas as shown, so that:

- Q and R lie on the upper parabola;
- RQ and SP are parallel to the x-axis;
- T, the turning point of the lower parabola, lies on SP.

(*a*) (i) If TP = x units, find an expression for the length of PQ.

(ii) Hence show that the area, A, of rectangle PQRS is given by

$$A(x) = 12x - 2x^3.$$ **3**

(*b*) Find the maximum area of this rectangle. **6**

[Turn over for Questions 6 and 7 on *Page six*

Marks

6. (*a*) A curve has equation $y = (2x - 9)^{\frac{1}{2}}$.

Show that the equation of the tangent to this curve at the point where $x = 9$ is $y = \frac{1}{3}x$. **5**

(*b*) Diagram 1 shows part of the curve and the tangent.

The curve cuts the x-axis at the point A.

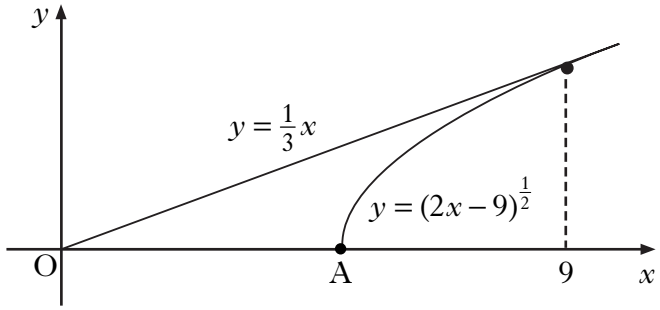

Diagram 1

Find the coordinates of point A. **1**

(*c*) Calculate the shaded area shown in diagram 2. **7**

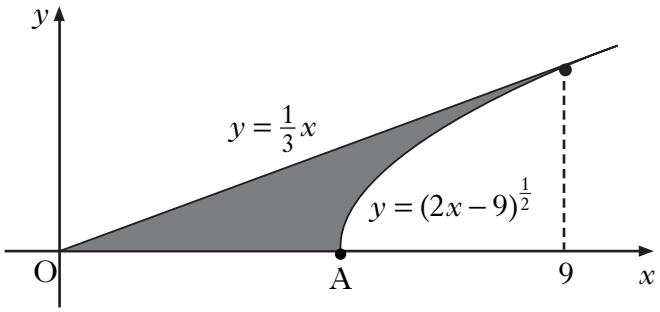

Diagram 2

7. (*a*) Given that $\log_4 x = \text{P}$, show that $\log_{16} x = \frac{1}{2}\text{P}$. **3**

(*b*) Solve $\log_3 x + \log_9 x = 12$. **3**

[*END OF QUESTION PAPER*]

[BLANK PAGE]

[BLANK PAGE]